Name: _____

Division Models Set 1

Directions: Read and solve.

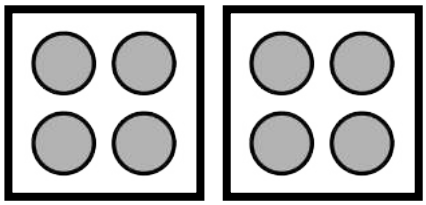

How many in all? ____

How many groups? ____

How many in each group? ____

____ ÷ ____ = _____ in each group.

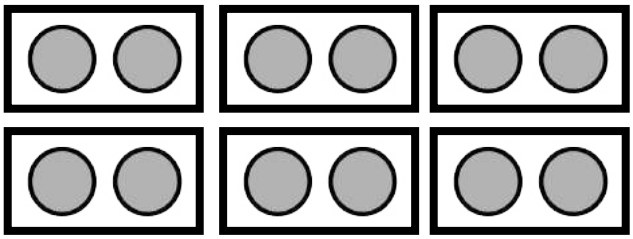

How many in all? ____

How many groups? ____

How many in each group? ____

____ ÷ ____ = _____ in each group.

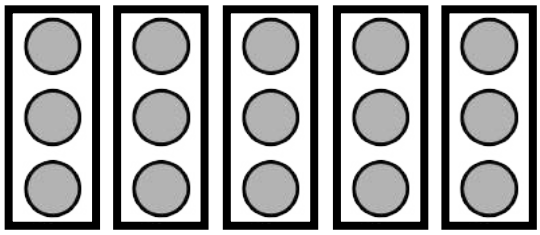

How many in all? ____

How many groups? ____

How many in each group? ____

____ ÷ ____ = _____ in each group.

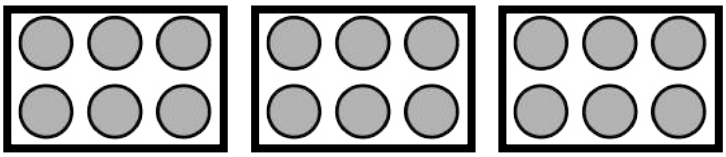

How many in all? ____

How many groups? ____

How many in each group? ____

____ ÷ ____ = _____ in each group.

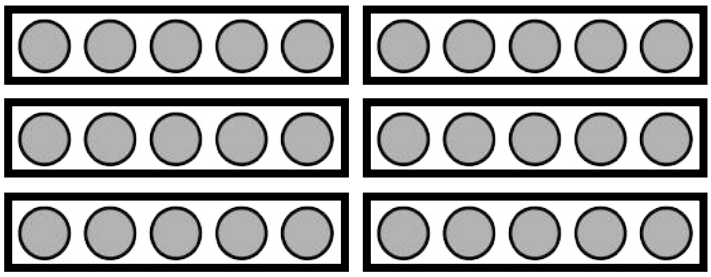

How many in all? ____

How many groups? ____

How many in each group? ____

____ ÷ ____ = _____ in each group.



How many in all? ____

How many groups? ____

How many in each group? ____

____ ÷ ____ = _____ in each group.

© Annie Moffatt @ The Moffatt Girls 2019